STRUCTURES OF OTHER ORGANIC COMPOUNDS

Name _____

Draw the structures of the compounds below.

1. butanoic acid	6. methylmethanoate (methyl formate)
2. methanal	7. 3-pentanol
3. methanol	8. methanoic acid (formic acid)
4. butanone	9. propanal
5. diethyl ether	10. 2-pentanone

©Instructional Fair, Inc.

NAMING OTHER ORGANIC COMPOUNDS

Name _____

Name the compounds below.

1.
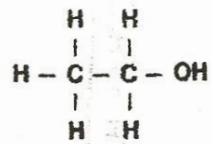

2.
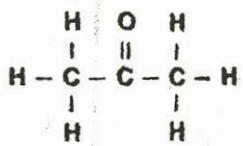

3.
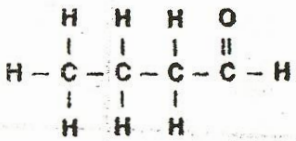

4.
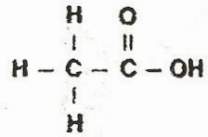

5.
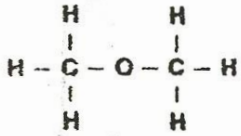

6.
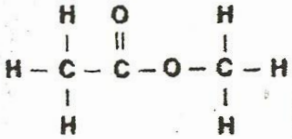

7.
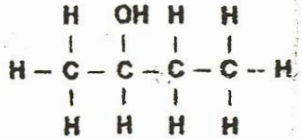

8.
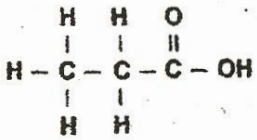

9.
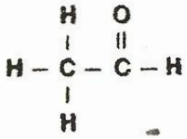

10.
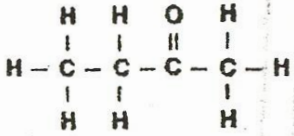

©Instructional Fair, Inc.